Name _____ Date _____

Quarter hour telling time worksheet no. 18

Read each clock to the quarter hour. Write the time like 4:15.

1

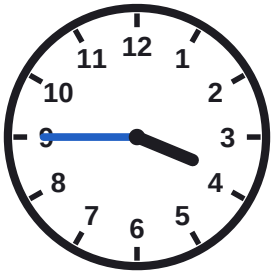

_____

2

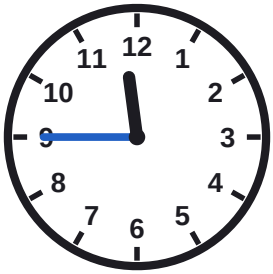

_____

3



_____

4



_____

5



_____

6



_____

7

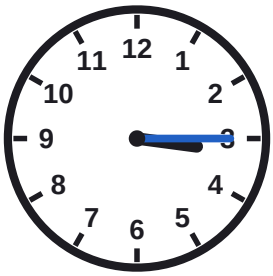

_____

8



_____

Name _____ Date _____

Answer key: Quarter hour telling time worksheet no. 18

Read each clock to the quarter hour. Write the time like 4:15.

1

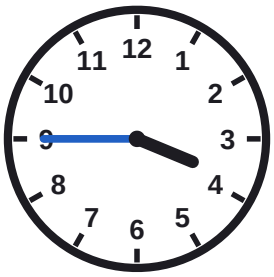

3:45

2



11:45

3



6:45

4



10:30

5



2:15

6



10:00

7

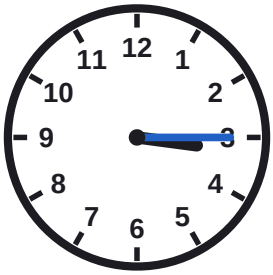

3:15

8



8:30