Name _____ Date _____

Quarter hour telling time worksheet no. 20

Read each clock to the quarter hour. Write the time like 4:15.

1



_____

2



_____

3

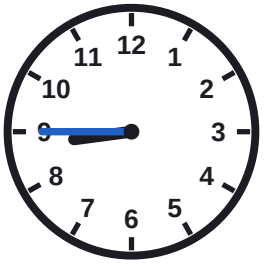

_____

4



_____

5



_____

6

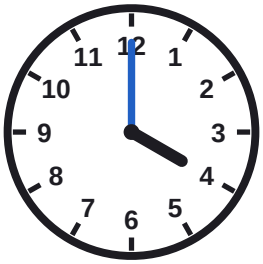

_____

7



_____

8



_____

Name _____ Date _____

Answer key: Quarter hour telling time worksheet no. 20

Read each clock to the quarter hour. Write the time like 4:15.

1



6:00

2



6:30

3

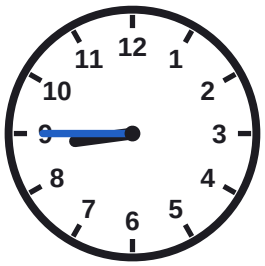

8:45

4



1:45

5



9:30

6



4:00

7



2:30

8



2:45